à propos

Admin

Raz

# Trigonométrie

## Exercices pour s'entrainer

Compléter le questionnaire en faisant moins de 5 erreurs

- Couleur des bonnes réponses : vert
- Couleur des mauvaises réponses : rouge

Nombre d'erreurs commises : 0

**Dans le triangle rectangle ABC rectangle en B, on donne :**
**AC = 70 mm | α = 15°**
**Calculer le côté adjacent AB (en mm, arrondi au centième).**

AB =

Vérifier Recommencer

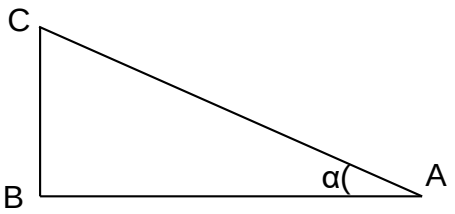


Aide

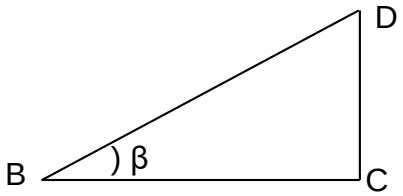


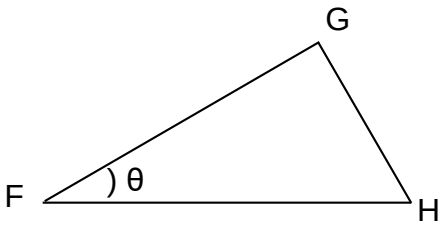

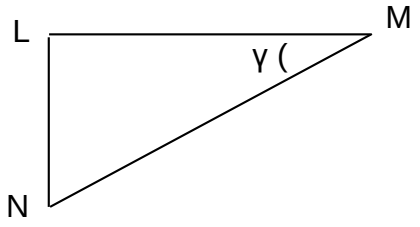
L
M
γ (
N

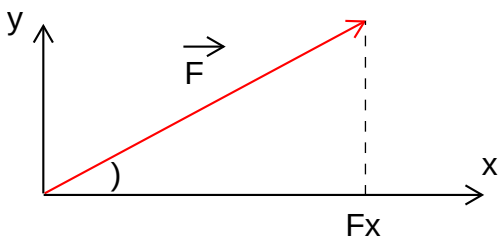
y
F
)
x
Fx

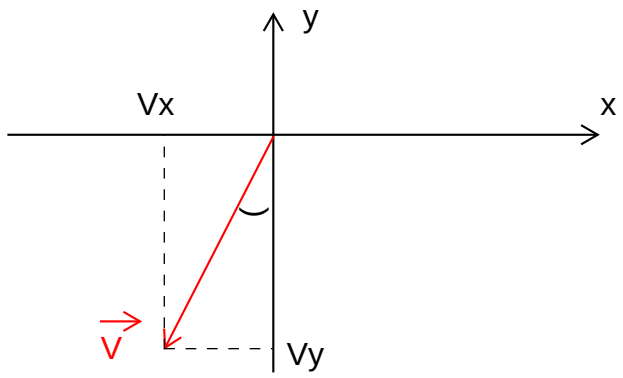
y
Vx
x
V
Vy

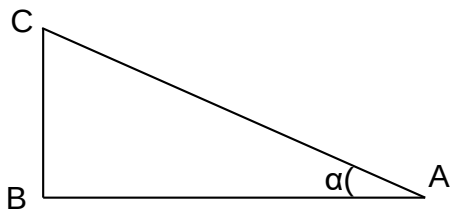
C
B
α(
A

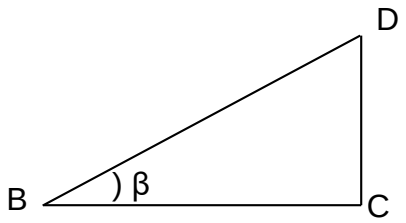
D
B
) β
C

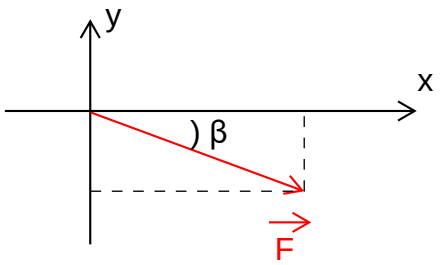
y
x
) β
F